Fractions

When something is split into 2 equal pieces, we call each piece a half.

How do we write the number half?

This is how many of those pieces

$$\frac{1}{2}$$

This is the number of pieces it is split into

Can you spot the shapes with half of the shape coloured?



How many are there?

What is a quarter?

When something is split into 4 equal pieces, we call each piece a quarter.



How do we write the number quarter?

This is how many of those pieces

$$\frac{1}{4}$$

This is the number of pieces it is split into

So what have we learned?

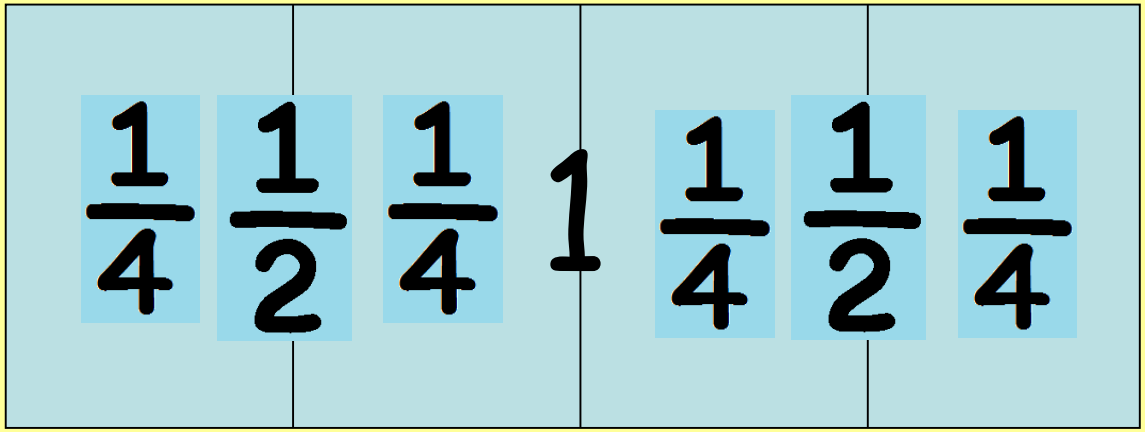

Can you spot the shapes with quarter of the shape coloured?





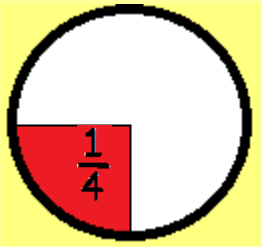

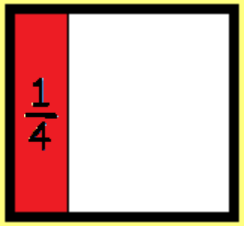

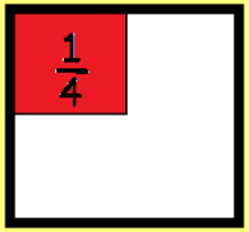



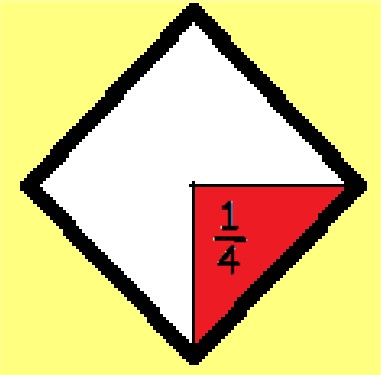

How many are there?

LO: To find half and a quarter of a shape.
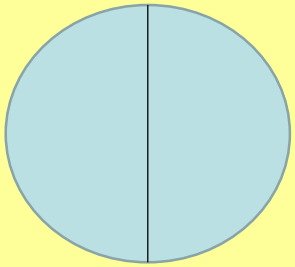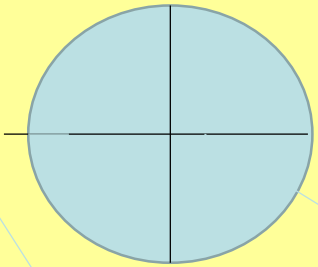
Use different shapes of paper fold some into $\frac{1}{2}$ and $\frac{1}{4}$. Write the fraction on each part. Colour in one of the halves on one shape. Colour in one of the quarters on another shape.